Time: 10 Minutes **Paper Math 5** **Total Marks: 10**

6th Month, 1st Week, 4th Day	**Syllabus: Unit 8:** Ex.# 1 Q No. 1, 2

Q.No.1. Find the area of given squares: **(10)**

سوال نمبر1: دیے گئے مربعوں کا رقبہ معلوم کریں:

(i)

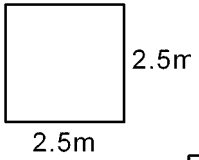

(ii)

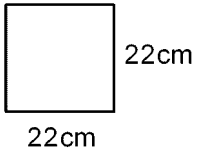

(iii)

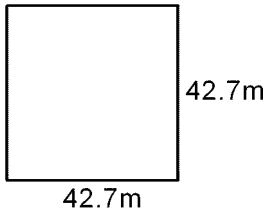

1

Time: 10 Minutes **Paper Math 5** **Total Marks: 10**

6th Month, 1st Week, 4th Day	**Syllabus: Unit 8:** Ex.# 1 Q No. 1, 2

Q.No.1. Find the area of given squares: **(10)**

سوال نمبر1: دیے گئے مربعوں کا رقبہ معلوم کریں:

(i)

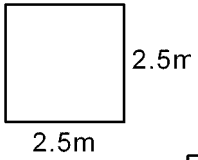

(ii)

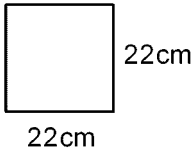
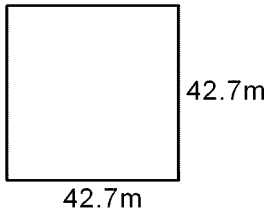
(iii)